Finding Angles within Shapes

Name:

Count the number of Acute, Obtuse, Right and Reflex angles in each shape.

Ex)

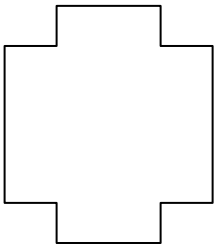

1)

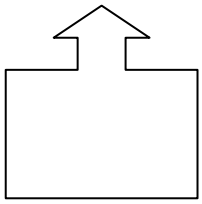

2)

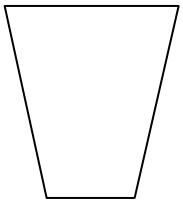

3)

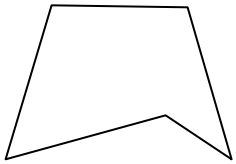

4)

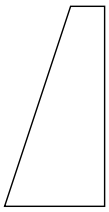

5)

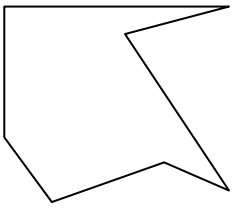

6)

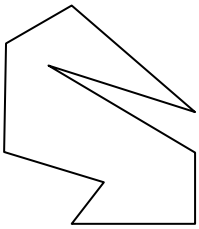

7)



8)



9)

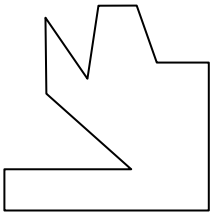

10)

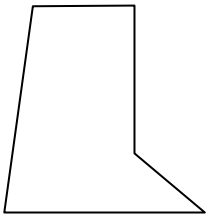

11)

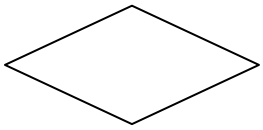

Answers

Ex.	0	0	8	4
1.				
2.				
3.				
4.				
5.				
6.				
7.				
8.				
9.				
10.				
11.				

1-10	91	82	73	64	55	45	36	27	18	9
11	0									

Finding Angles within Shapes

Name: **Answer Key**

Count the number of Acute, Obtuse, Right and Reflex angles in each shape.

Ex)

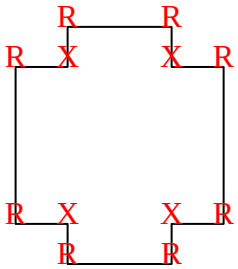

1)

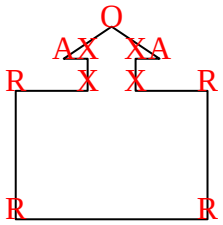

2)

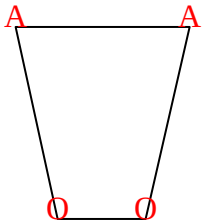

3)

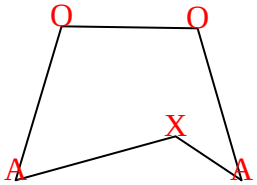

4)

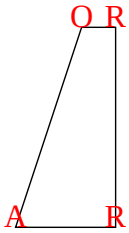

5)

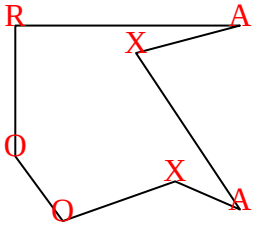

6)

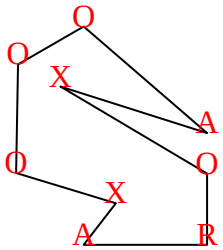

7)

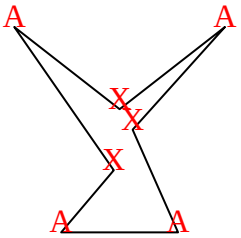

8)



9)

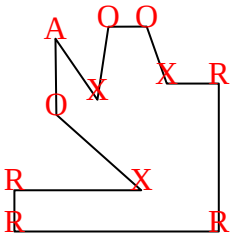

10)

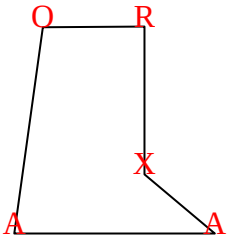

11)

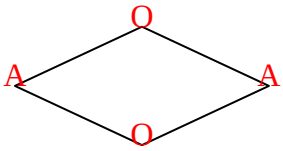

Answers

Ex.	0	0	8	4
1.	2	1	4	4
2.	2	2	0	0
3.	2	2	0	1
4.	1	1	2	0
5.	2	2	1	2
6.	2	4	1	2
7.	4	0	0	3
8.	0	0	4	0
9.	1	3	4	3
10.	2	1	1	1
11.	2	2	0	0

1-10	91	82	73	64	55	45	36	27	18	9
11	0									