Fraction Quantity Relative to Whole

Name:

Solve each problem.

Ex) Express the triangles as a fraction of the entire set.

1) Express the stars as a fraction of the entire set.

2) Express the moons as a fraction of the entire set.

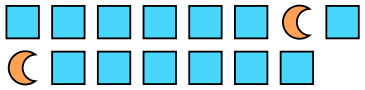

3) Express the pentagons as a fraction of the entire set.



4) Express the stars as a fraction of the entire set.

5) Express the moons as a fraction of the entire set.



6) Express the stars as a fraction of the entire set.

7) Express the circles as a fraction of the entire set.



8) Express the circles as a fraction of the entire set.



9) Express the pentagons as a fraction of the entire set.

10) Express the pentagons as a fraction of the entire set.

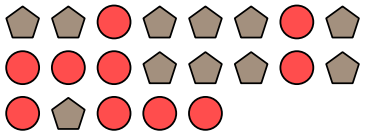

11) Express the squares as a fraction of the entire set.



Answers

Ex. 4/16

1. _____
2. _____
3. _____
4. _____
5. _____
6. _____
7. _____
8. _____
9. _____
10. _____
11. _____

1-10	91	82	73	64	55	45	36	27	18	9
11	0									

Fraction Quantity Relative to Whole

Name: **Answer Key**

Solve each problem.

Ex) Express the triangles as a fraction of the entire set.

1) Express the stars as a fraction of the entire set.

2) Express the moons as a fraction of the entire set.

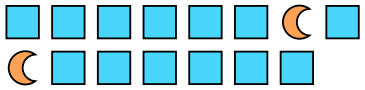

3) Express the pentagons as a fraction of the entire set.



4) Express the stars as a fraction of the entire set.

5) Express the moons as a fraction of the entire set.



6) Express the stars as a fraction of the entire set.

7) Express the circles as a fraction of the entire set.



8) Express the circles as a fraction of the entire set.



9) Express the pentagons as a fraction of the entire set.

10) Express the pentagons as a fraction of the entire set.

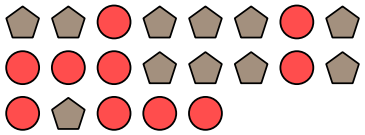

11) Express the squares as a fraction of the entire set.



Answers

Ex.	4/16
1.	9/21
2.	2/15
3.	10/23
4.	12/17
5.	15/26
6.	7/16
7.	12/19
8.	8/23
9.	7/11
10.	11/21
11.	4/10

1-10	91	82	73	64	55	45	36	27	18	9
11	0									