Function Machines (Add & Subtract) Name:

Determine the rule each function machine is using.

Ex)

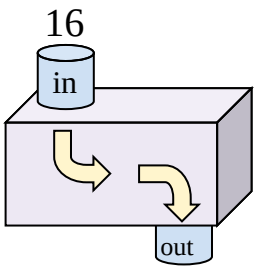

Add 12

1)

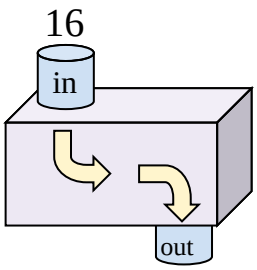

2)

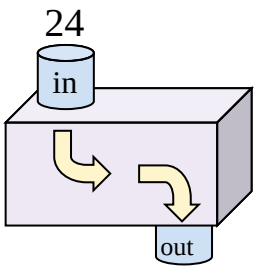

3)

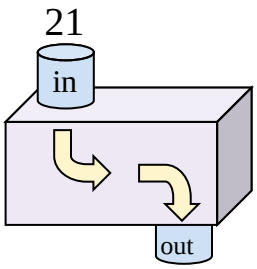

4)

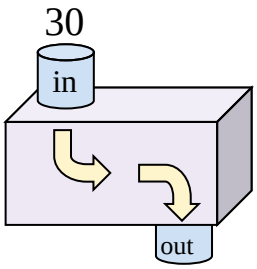

5)

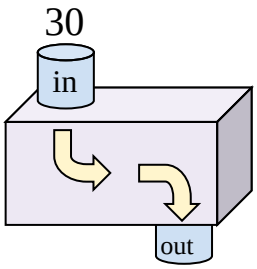

6)

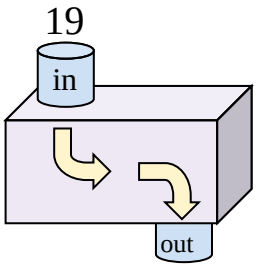

7)

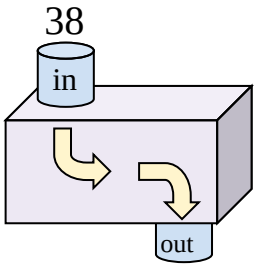

8)

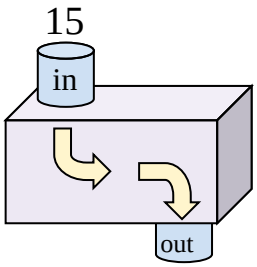

9)

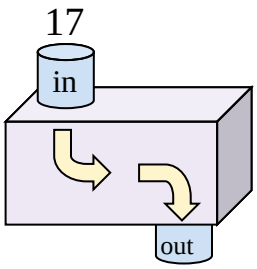

10)

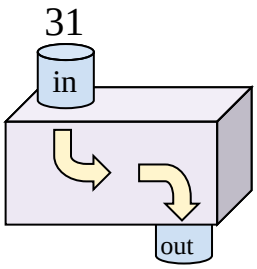

11)

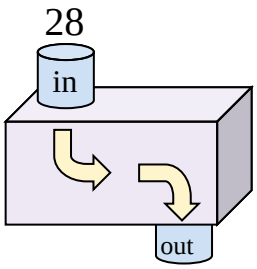

Answers

Ex. **Add 12**

1. _____
2. _____
3. _____
4. _____
5. _____
6. _____
7. _____
8. _____
9. _____
10. _____
11. _____

1-10	91	82	73	64	55	45	36	27	18	9
11	0									

Function Machines (Add & Subtract) Name: **Answer Key**

Determine the rule each function machine is using.

Ex)

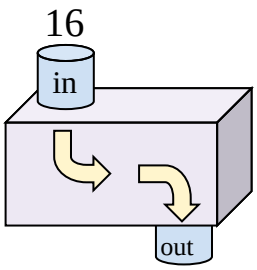

Add 12

1)

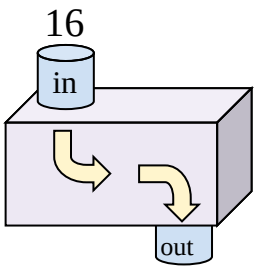

Add 6

2)

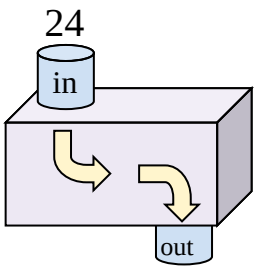

Subtract 17

3)

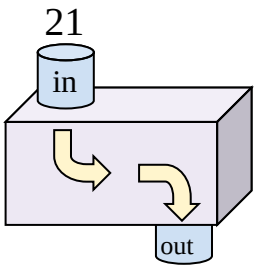

Add 14

4)

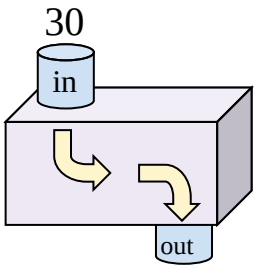

Subtract 17

5)

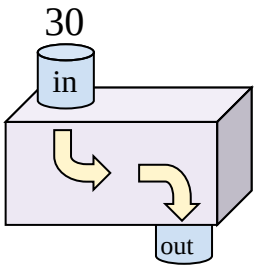

Subtract 7

6)

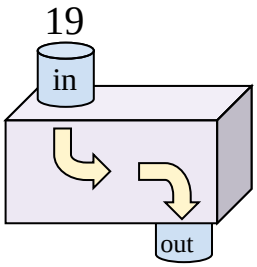

Add 13

7)

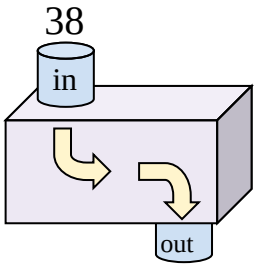

Subtract 17

8)

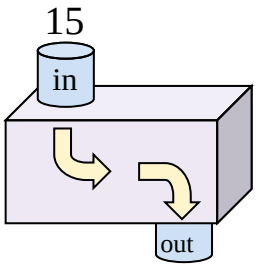

Add 8

9)

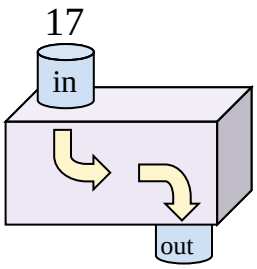

Add 15

10)

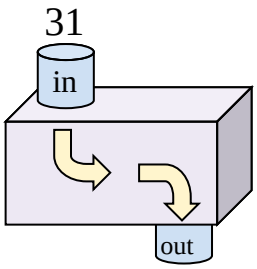

Subtract 24

11)

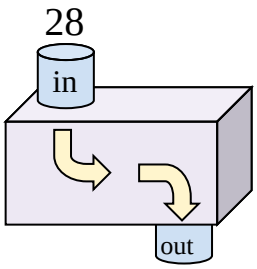

Subtract 18

Answers

Ex.	Add 12
1.	Add 6
2.	Subtract 17
3.	Add 14
4.	Subtract 17
5.	Subtract 7
6.	Add 13
7.	Subtract 17
8.	Add 8
9.	Add 15
10.	Subtract 24
11.	Subtract 18

1-10	91	82	73	64	55	45	36	27	18	9
11	0									

Function Machines (Add & Subtract) Name:

Determine the rule each function machine is using.

Ex)

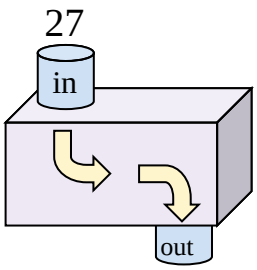

Subtract 5

1)

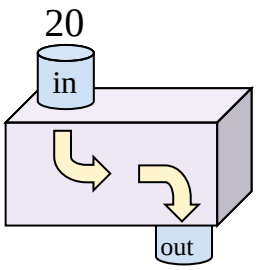

2)

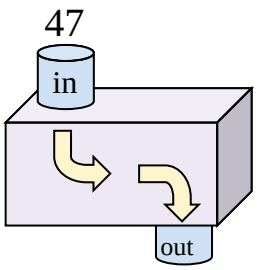

3)

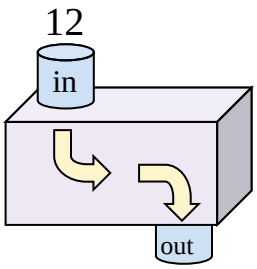

4)

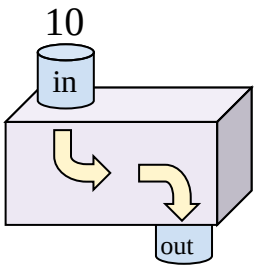

5)

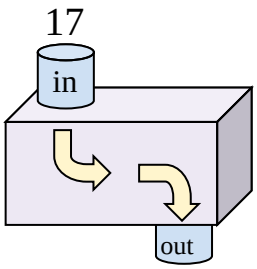

6)

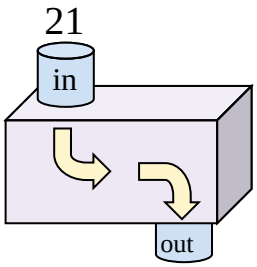

7)

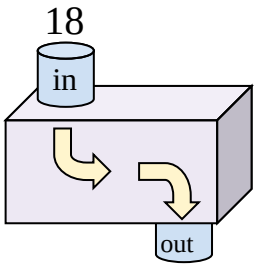

8)

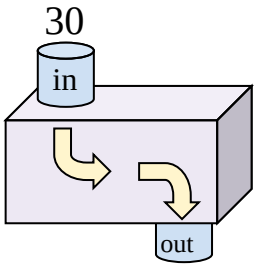

9)

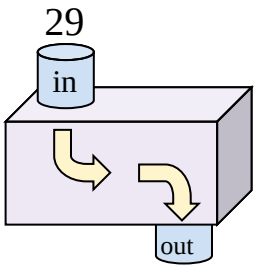

10)

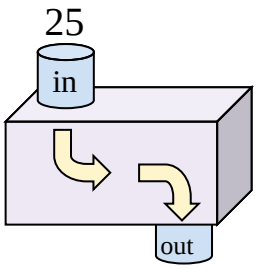

11)

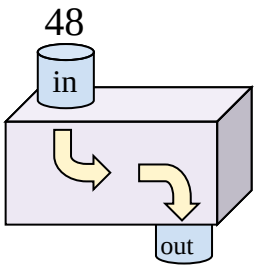

Answers

Ex. Subtract 5

1. _____
2. _____
3. _____
4. _____
5. _____
6. _____
7. _____
8. _____
9. _____
10. _____
11. _____

1-10	91	82	73	64	55	45	36	27	18	9
11	0									

Function Machines (Add & Subtract) Name: **Answer Key**

Determine the rule each function machine is using.

Ex)

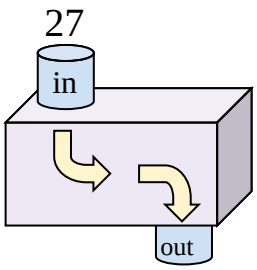

Subtract 5

1)

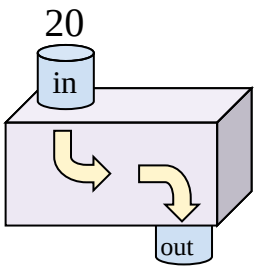

Add 14

2)

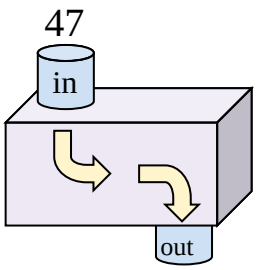

Subtract 33

3)

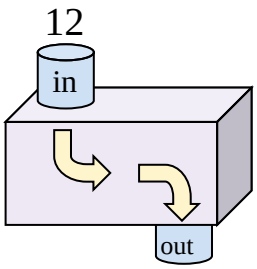

Add 27

4)

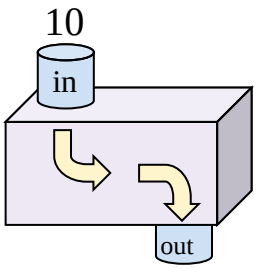

Add 30

5)

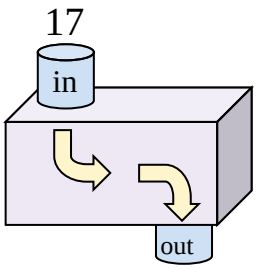

Add 25

6)

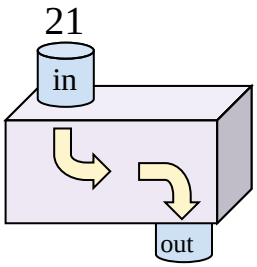

Add 24

7)

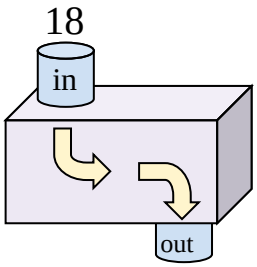

Subtract 12

8)

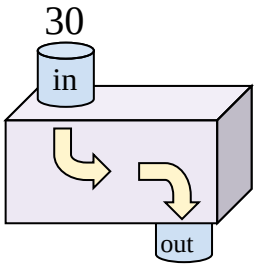

Subtract 6

9)

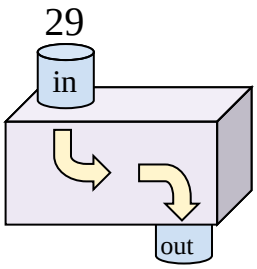

Add 18

10)

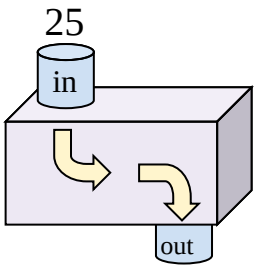

Add 5

11)

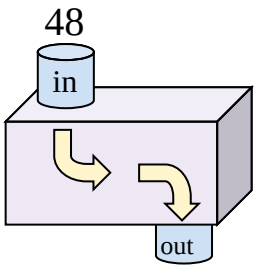

Subtract 31

Answers

Ex.	Subtract 5
1.	Add 14
2.	Subtract 33
3.	Add 27
4.	Add 30
5.	Add 25
6.	Add 24
7.	Subtract 12
8.	Subtract 6
9.	Add 18
10.	Add 5
11.	Subtract 31

1-10	91	82	73	64	55	45	36	27	18	9
11	0									

Function Machines (Add & Subtract) Name:

Determine the rule each function machine is using.

Ex)

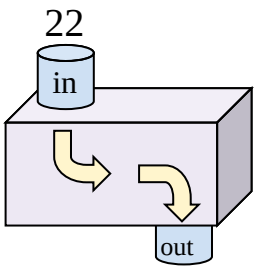

Add 20

1)

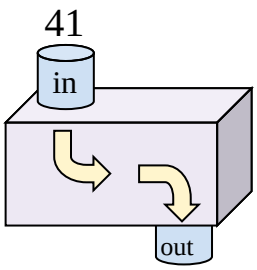

2)

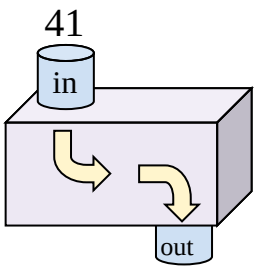

3)

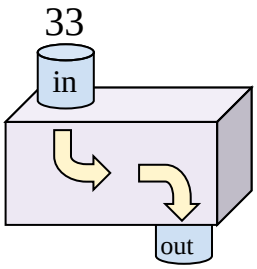

4)

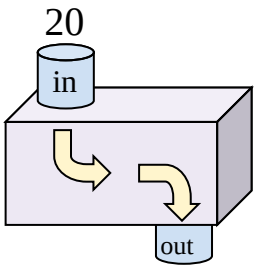

5)

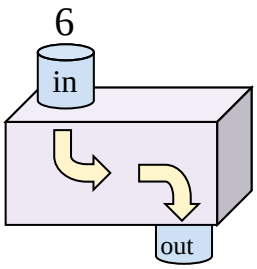

6)

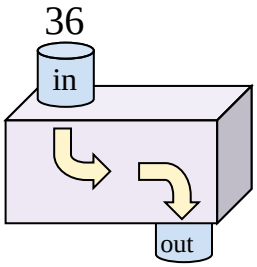

7)

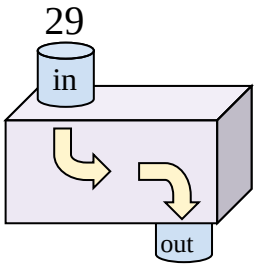

8)

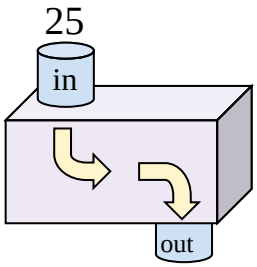

9)

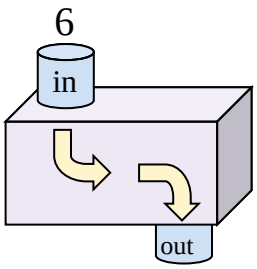

10)

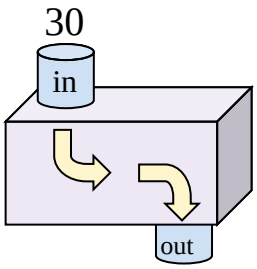

11)

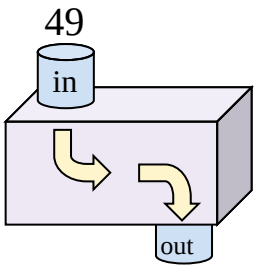

Answers

Ex. Add 20

1. _____
2. _____
3. _____
4. _____
5. _____
6. _____
7. _____
8. _____
9. _____
10. _____
11. _____

1-10	91	82	73	64	55	45	36	27	18	9
11	0									

Function Machines (Add & Subtract) Name: **Answer Key**

Determine the rule each function machine is using.

Ex)

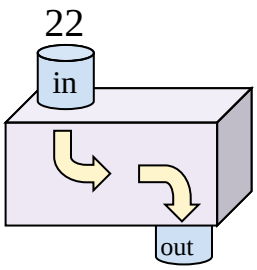

Add 20

1)

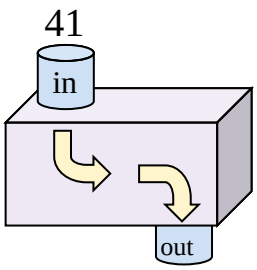

Subtract 18

2)

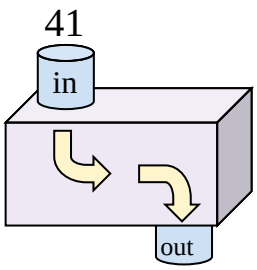

Subtract 33

3)

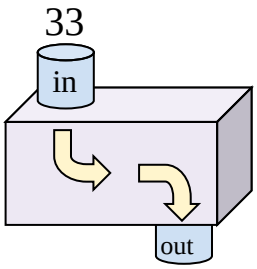

Subtract 16

4)

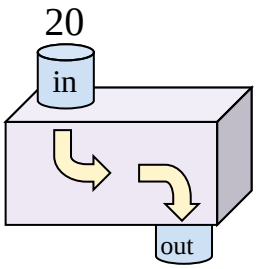

Subtract 8

5)

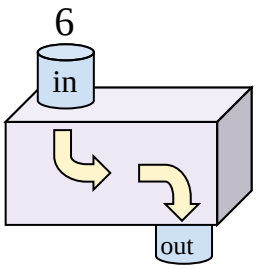

Add 37

6)

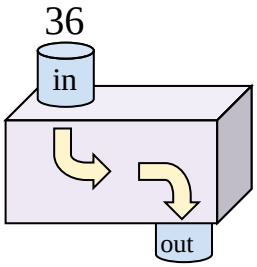

Subtract 11

7)

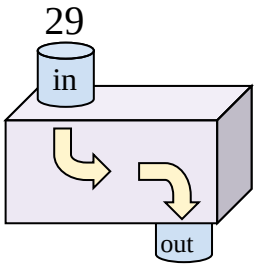

Add 15

8)

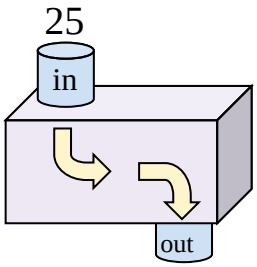

Add 25

9)

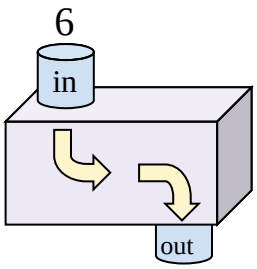

Add 10

10)

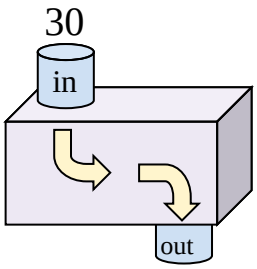

Subtract 16

11)

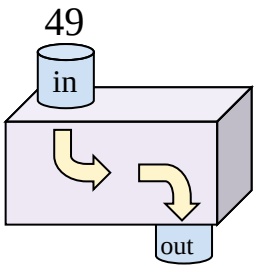

Subtract 29

Answers

Ex. **Add 20**

1. **Subtract 18**
2. **Subtract 33**
3. **Subtract 16**
4. **Subtract 8**
5. **Add 37**
6. **Subtract 11**
7. **Add 15**
8. **Add 25**
9. **Add 10**
10. **Subtract 16**
11. **Subtract 29**

1-10	91	82	73	64	55	45	36	27	18	9
11	0									

Function Machines (Add & Subtract) Name:

Determine the rule each function machine is using.

Ex)

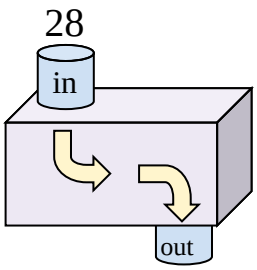

Add 8

1)

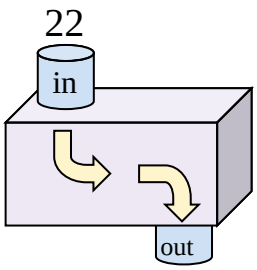

2)

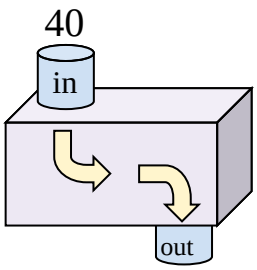

3)

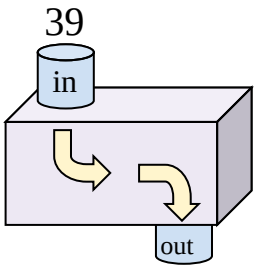

4)

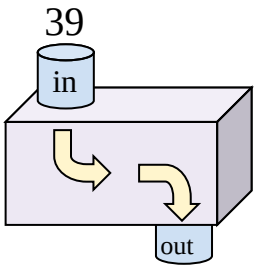

5)

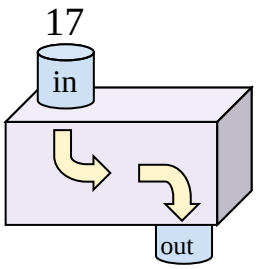

6)

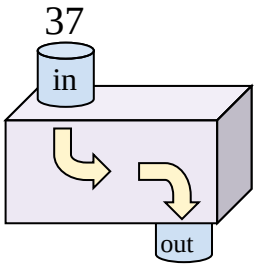

7)

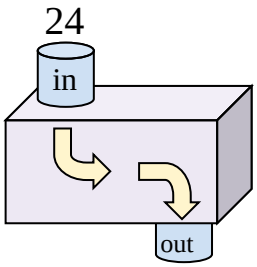

8)

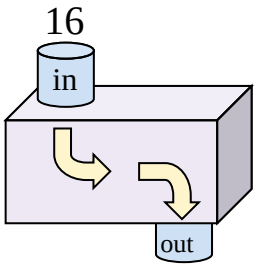

9)

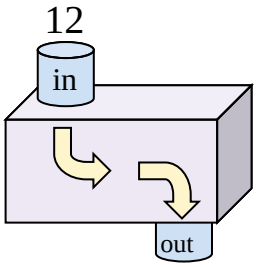

10)

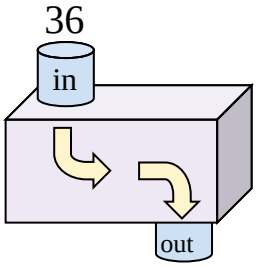

11)

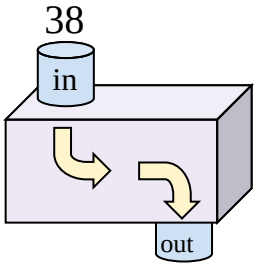

Answers

Ex. Add 8

1. _____
2. _____
3. _____
4. _____
5. _____
6. _____
7. _____
8. _____
9. _____
10. _____
11. _____

1-10	91	82	73	64	55	45	36	27	18	9
11	0									

Function Machines (Add & Subtract) Name: **Answer Key**

Determine the rule each function machine is using.

Ex)

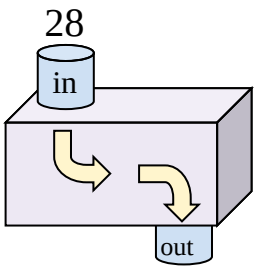

Add 8

1)

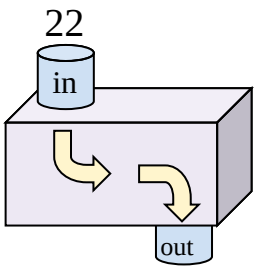

Add 6

2)

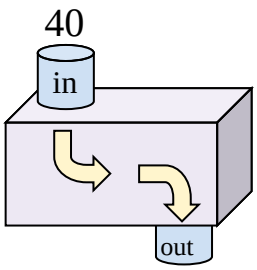

Subtract 16

3)

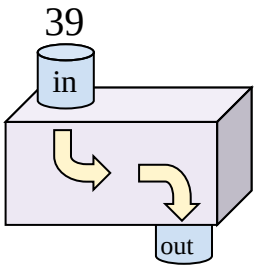

Subtract 17

4)

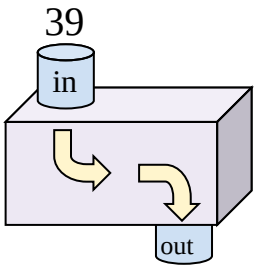

Subtract 32

5)

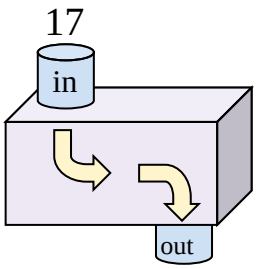

Subtract 6

6)

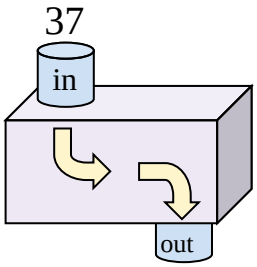

Subtract 14

7)

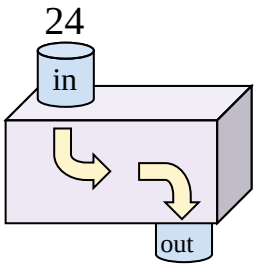

Add 18

8)

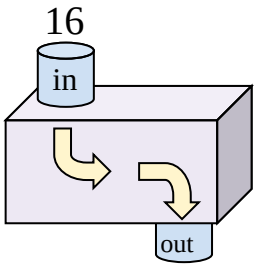

Add 33

9)

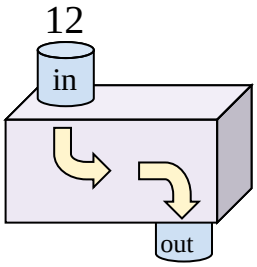

Add 34

10)

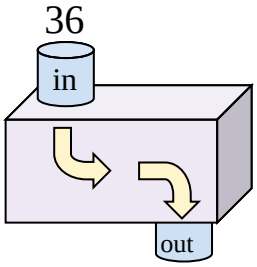

Subtract 26

11)

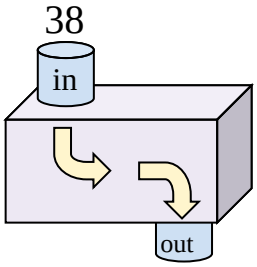

Subtract 9

Answers

Ex.	Add 8
1.	Add 6
2.	Subtract 16
3.	Subtract 17
4.	Subtract 32
5.	Subtract 6
6.	Subtract 14
7.	Add 18
8.	Add 33
9.	Add 34
10.	Subtract 26
11.	Subtract 9

1-10	91	82	73	64	55	45	36	27	18	9
11	0									

Function Machines (Add & Subtract) Name:

Determine the rule each function machine is using.

Ex)

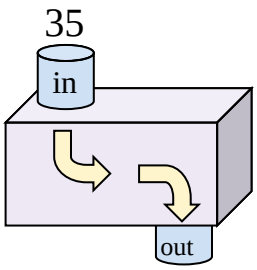

Subtract 13

1)

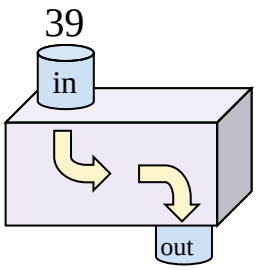

2)

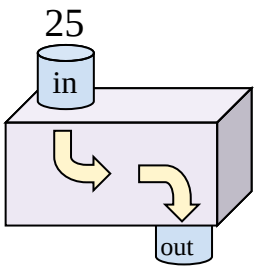

3)

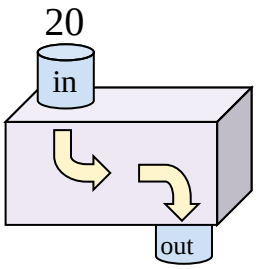

4)

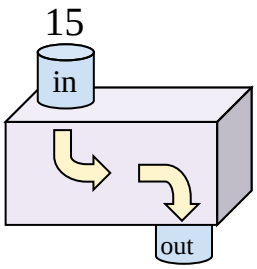

5)

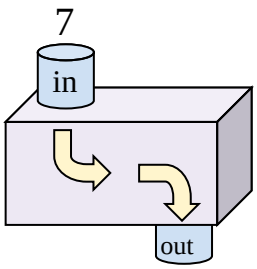

6)

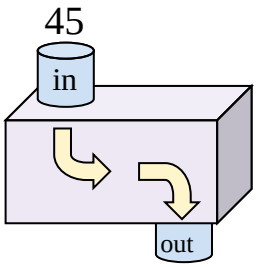

7)

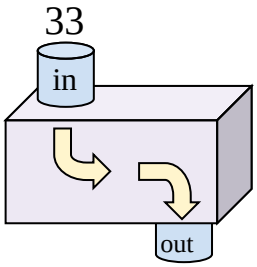

8)

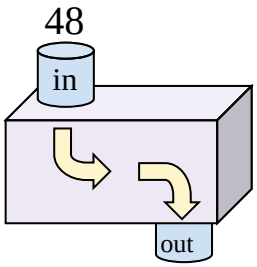

9)

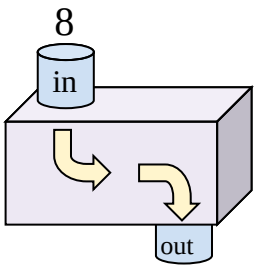

10)

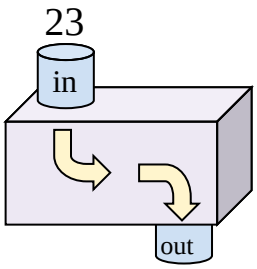

11)

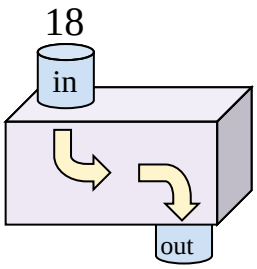

Answers

Ex. Subtract 13

1. _____
2. _____
3. _____
4. _____
5. _____
6. _____
7. _____
8. _____
9. _____
10. _____
11. _____

1-10	91	82	73	64	55	45	36	27	18	9
11	0									

Function Machines (Add & Subtract) Name: **Answer Key**

Determine the rule each function machine is using.

Ex)

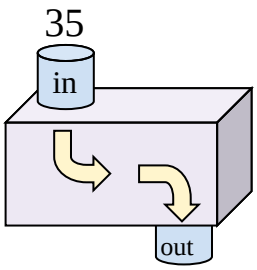

Subtract 13

1)

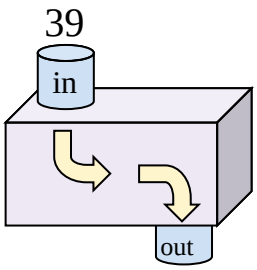

Subtract 31

2)

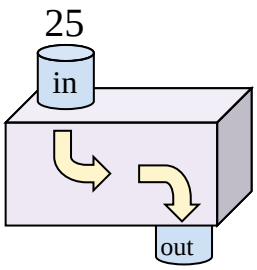

Add 10

3)

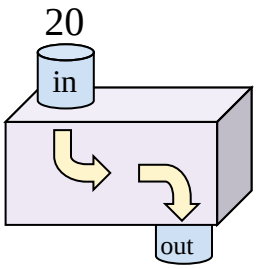

Add 8

4)

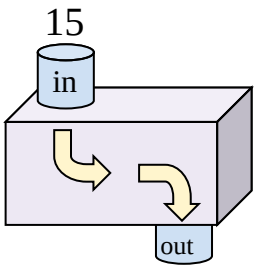

Add 34

5)

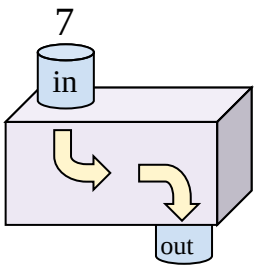

Add 21

6)

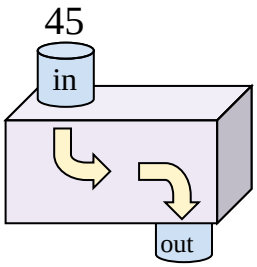

Subtract 21

7)

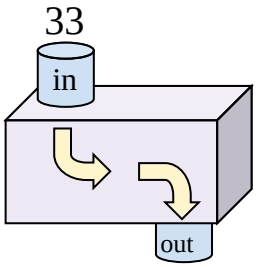

Subtract 13

8)

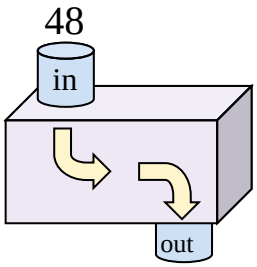

Subtract 28

9)

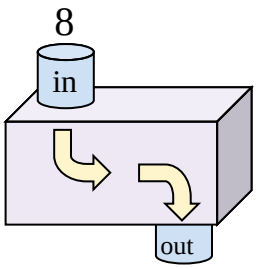

Add 38

10)

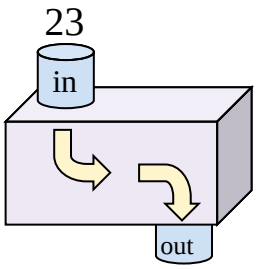

Add 12

11)

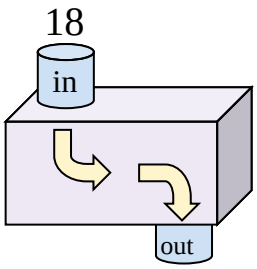

Add 6

Answers

Ex.	Subtract 13
1.	Subtract 31
2.	Add 10
3.	Add 8
4.	Add 34
5.	Add 21
6.	Subtract 21
7.	Subtract 13
8.	Subtract 28
9.	Add 38
10.	Add 12
11.	Add 6

1-10	91	82	73	64	55	45	36	27	18	9
11	0									

Function Machines (Add & Subtract) Name:

Determine the rule each function machine is using.

Ex)

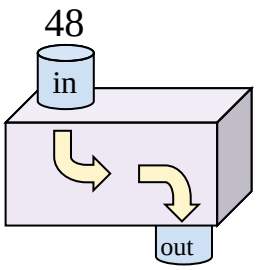

Subtract 33

1)

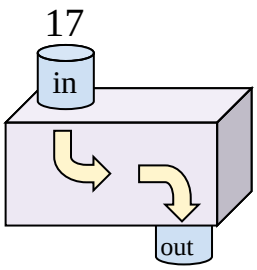

2)

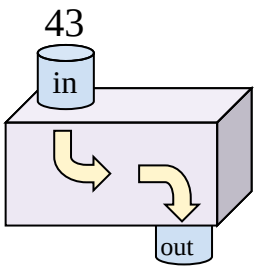

3)

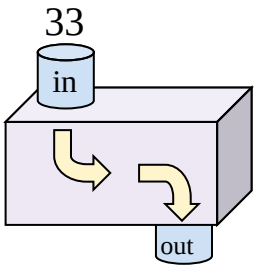

4)

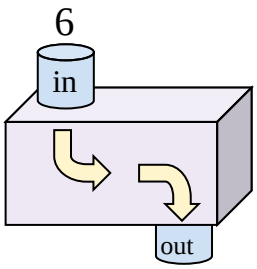

5)

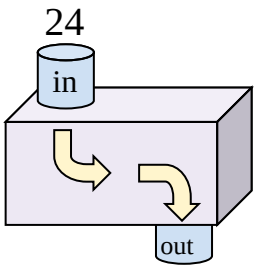

6)

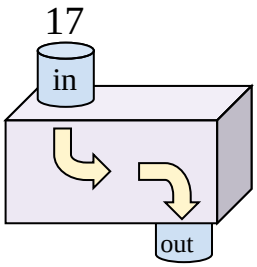

7)

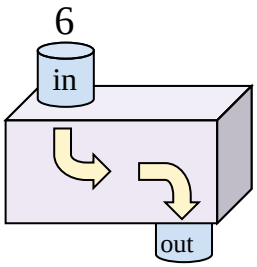

8)

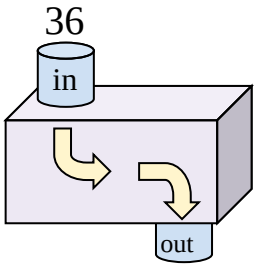

9)

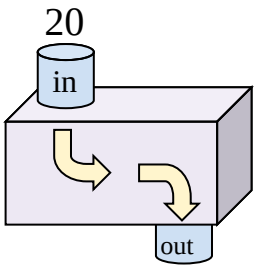

10)

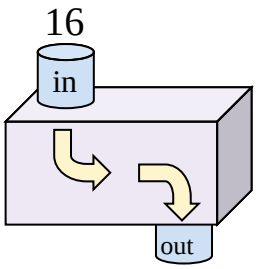

11)

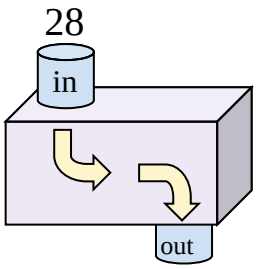

Answers

Ex. Subtract 33

1. _____
2. _____
3. _____
4. _____
5. _____
6. _____
7. _____
8. _____
9. _____
10. _____
11. _____

1-10	91	82	73	64	55	45	36	27	18	9
11	0									

Function Machines (Add & Subtract) Name: **Answer Key**

Determine the rule each function machine is using.

Ex)

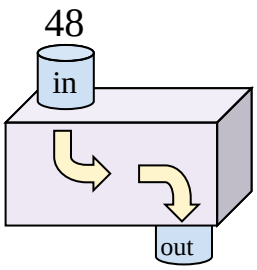

Subtract 33

1)

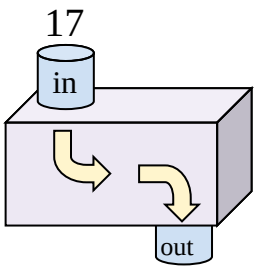

Add 15

2)

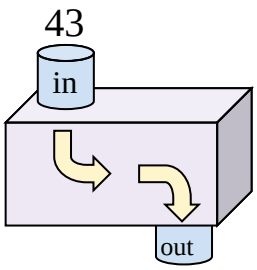

Subtract 23

3)

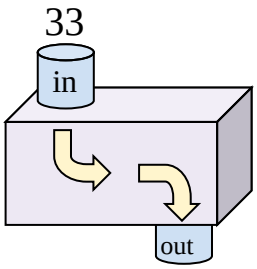

Subtract 15

4)

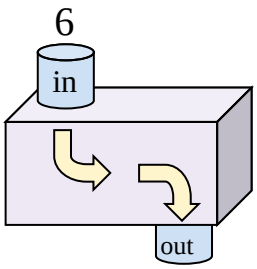

Add 36

5)

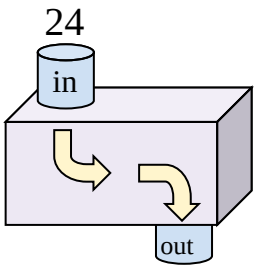

Add 14

6)

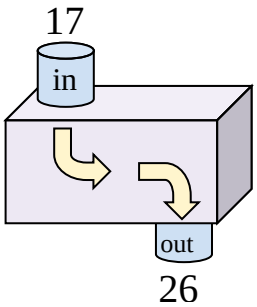

Add 9

7)

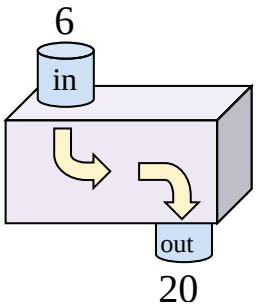

Add 14

8)

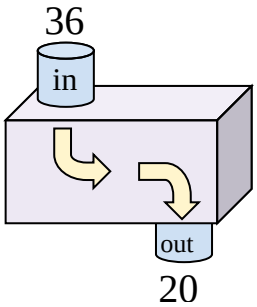

Subtract 16

9)

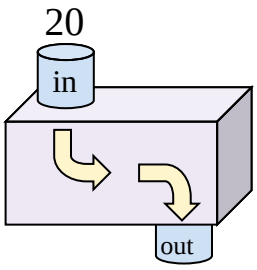

Add 8

10)

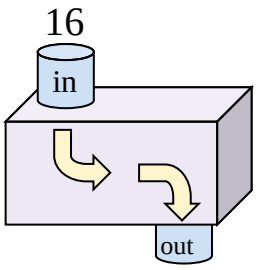

Add 19

11)

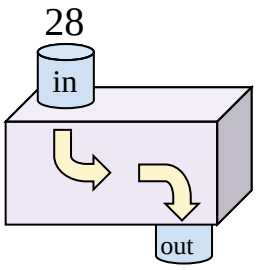

Subtract 9

Answers

Ex.	Subtract 33
1.	Add 15
2.	Subtract 23
3.	Subtract 15
4.	Add 36
5.	Add 14
6.	Add 9
7.	Add 14
8.	Subtract 16
9.	Add 8
10.	Add 19
11.	Subtract 9

1-10	91	82	73	64	55	45	36	27	18	9
11	0									

Function Machines (Add & Subtract) Name:

Determine the rule each function machine is using.

Ex)

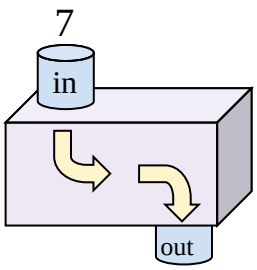

Add 13

1)

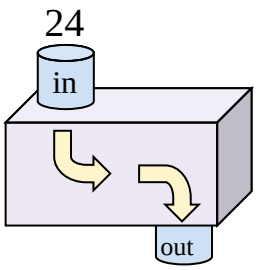

2)

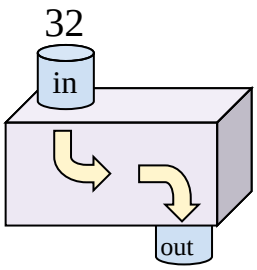

3)

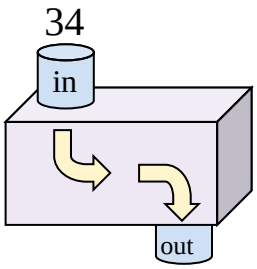

4)

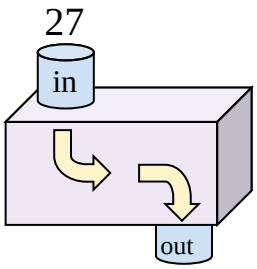

5)

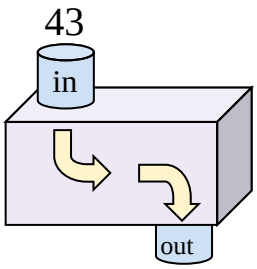

6)

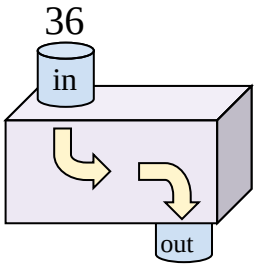

7)

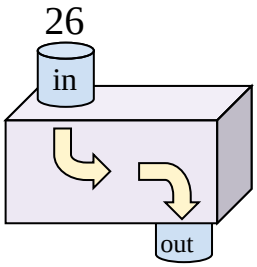

8)

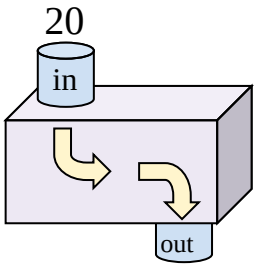

9)

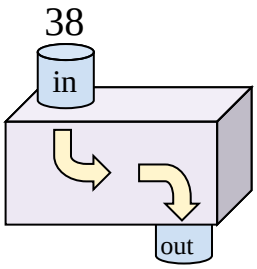

10)

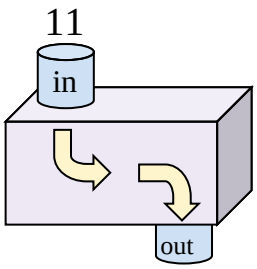

11)

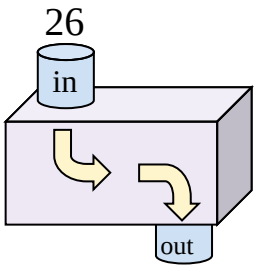

Answers

Ex. Add 13

1. _____
2. _____
3. _____
4. _____
5. _____
6. _____
7. _____
8. _____
9. _____
10. _____
11. _____

1-10	91	82	73	64	55	45	36	27	18	9
11	0									

Function Machines (Add & Subtract) Name: **Answer Key**

Determine the rule each function machine is using.

Ex)

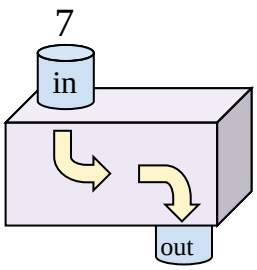

Add 13

1)

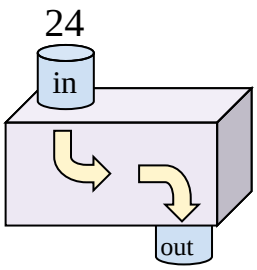

Add 9

2)

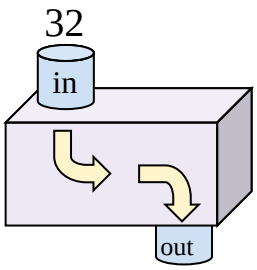

Subtract 23

3)

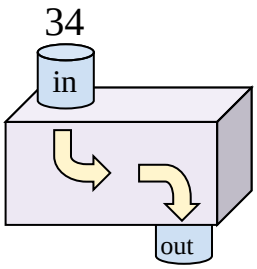

Subtract 5

4)

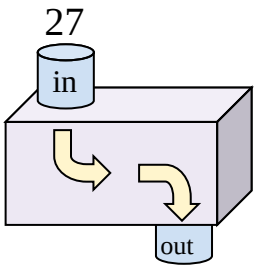

Add 10

5)

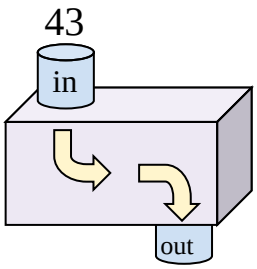

Subtract 17

6)

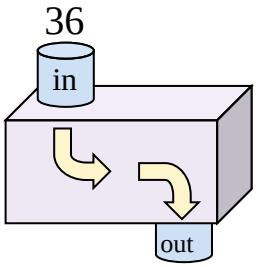

Subtract 16

7)

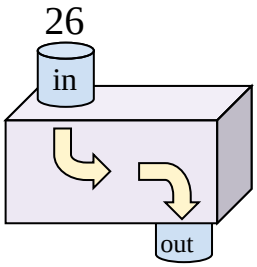

Add 5

8)

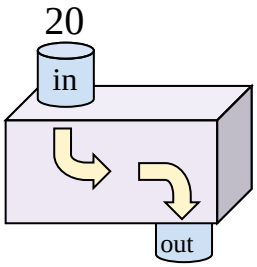

Add 13

9)

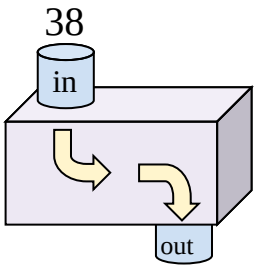

Subtract 26

10)

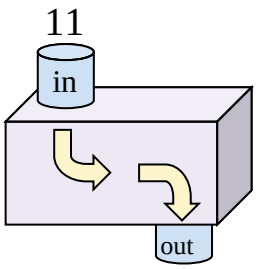

Add 8

11)

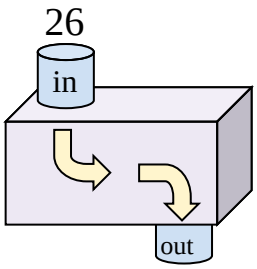

Subtract 16

Answers

Ex.	Add 13
1.	Add 9
2.	Subtract 23
3.	Subtract 5
4.	Add 10
5.	Subtract 17
6.	Subtract 16
7.	Add 5
8.	Add 13
9.	Subtract 26
10.	Add 8
11.	Subtract 16

1-10	91	82	73	64	55	45	36	27	18	9
11	0									

Function Machines (Add & Subtract) Name:

Determine the rule each function machine is using.

Ex)

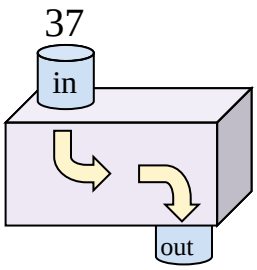

Subtract 14

1)

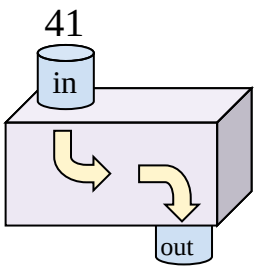

2)

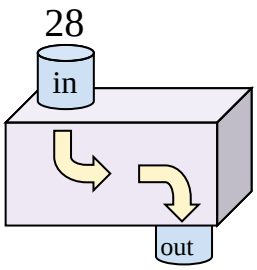

3)

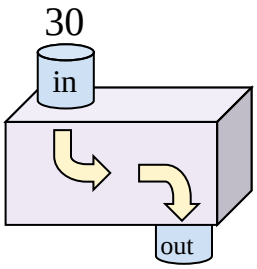

4)

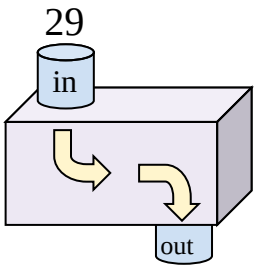

5)

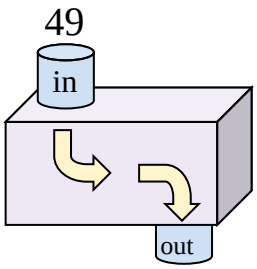

6)

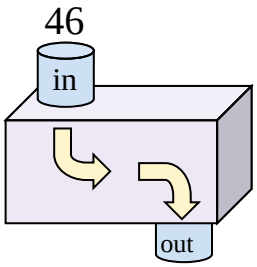

7)

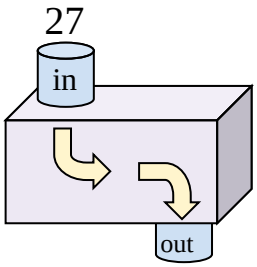

8)

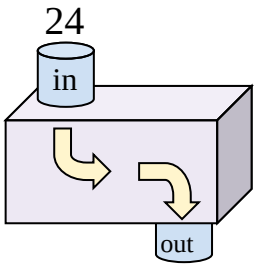

9)

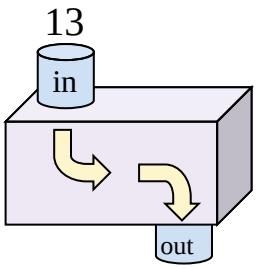

10)

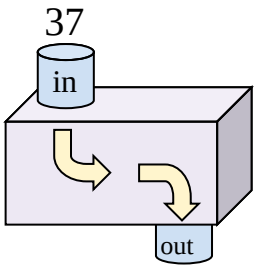

11)

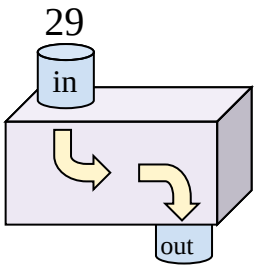

Answers

Ex. Subtract 14

1. _____
2. _____
3. _____
4. _____
5. _____
6. _____
7. _____
8. _____
9. _____
10. _____
11. _____

1-10	91	82	73	64	55	45	36	27	18	9
11	0									

Function Machines (Add & Subtract) Name: **Answer Key**

Determine the rule each function machine is using.

Ex)

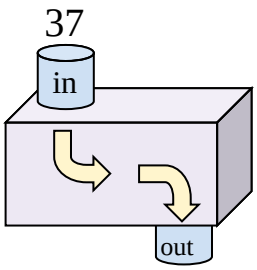

Subtract 14

1)

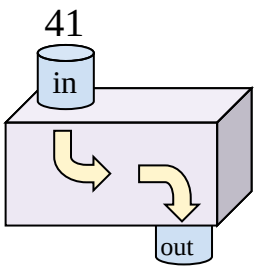

Subtract 19

2)

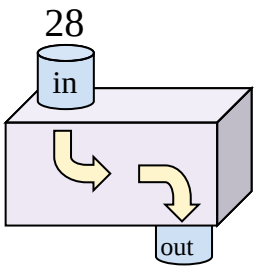

Add 16

3)

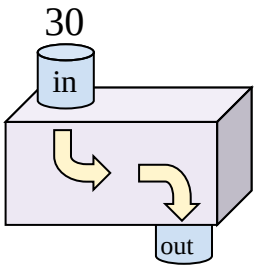

Add 14

4)

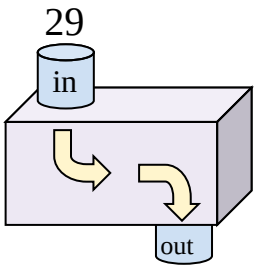

Add 21

5)

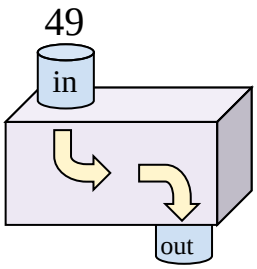

Subtract 33

6)

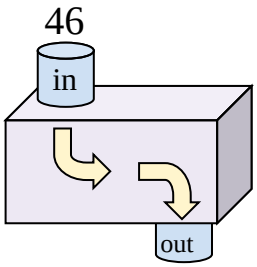

Subtract 29

7)

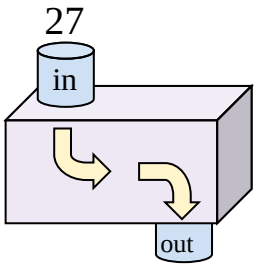

Add 9

8)

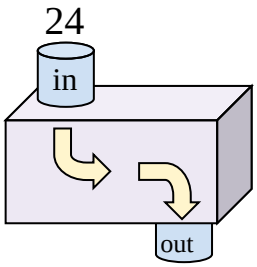

Add 6

9)

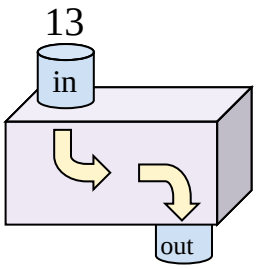

Add 12

10)

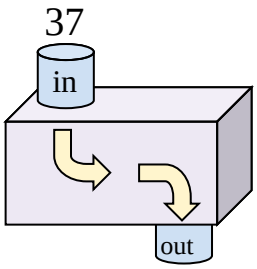

Subtract 7

11)

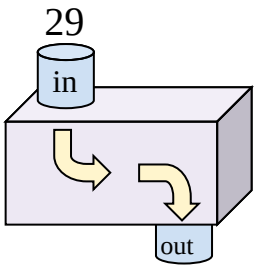

Add 16

Answers

Ex.	Subtract 14
1.	Subtract 19
2.	Add 16
3.	Add 14
4.	Add 21
5.	Subtract 33
6.	Subtract 29
7.	Add 9
8.	Add 6
9.	Add 12
10.	Subtract 7
11.	Add 16

1-10	91	82	73	64	55	45	36	27	18	9
11	0									

Function Machines (Add & Subtract) Name:

Determine the rule each function machine is using.

Ex)

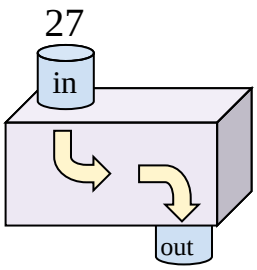

Add 12

1)

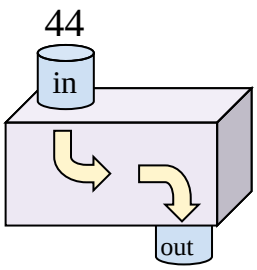

2)

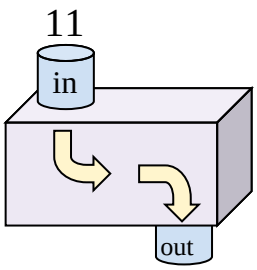

3)

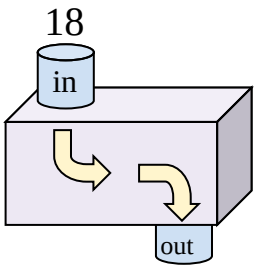

4)

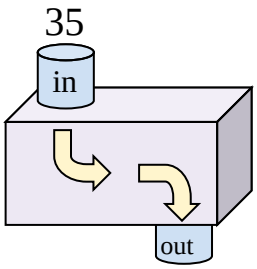

5)

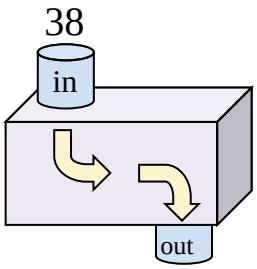

6)

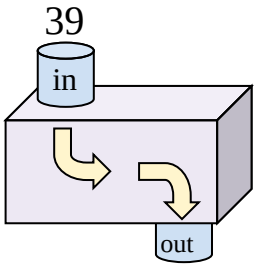

7)

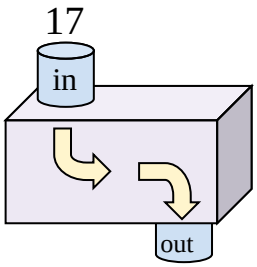

8)

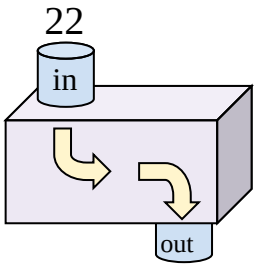

9)

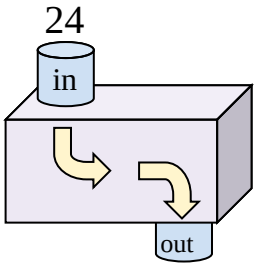

10)

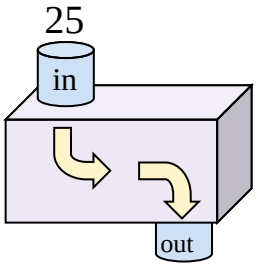

11)

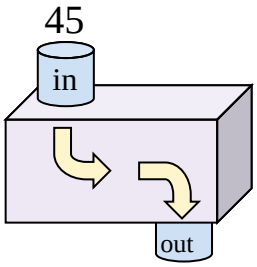

Answers

Ex. Add 12

1. _____
2. _____
3. _____
4. _____
5. _____
6. _____
7. _____
8. _____
9. _____
10. _____
11. _____

1-10	91	82	73	64	55	45	36	27	18	9
11	0									

Function Machines (Add & Subtract) Name: **Answer Key**

Determine the rule each function machine is using.

Ex)

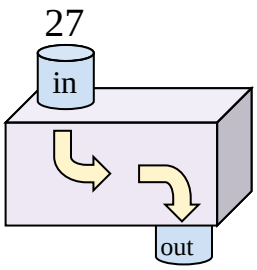

Add 12

1)

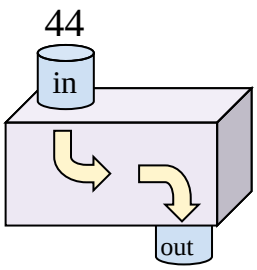

Subtract 30

2)

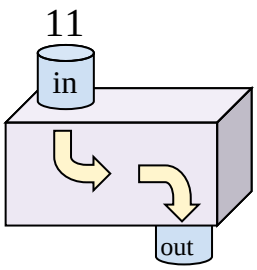

Add 8

3)

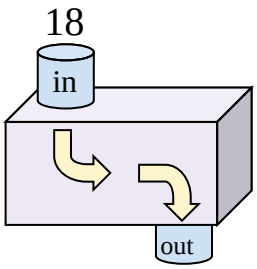

Add 30

4)

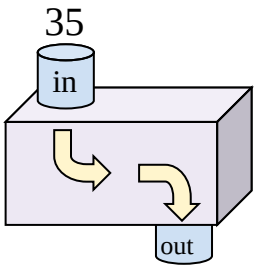

Subtract 26

5)

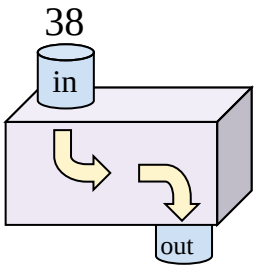

Subtract 22

6)

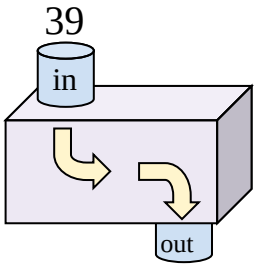

Subtract 21

7)

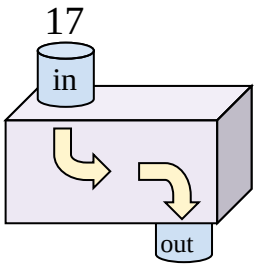

Add 18

8)

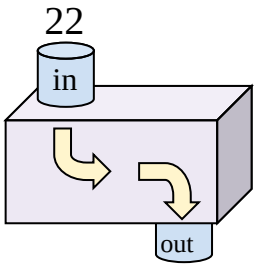

Subtract 5

9)

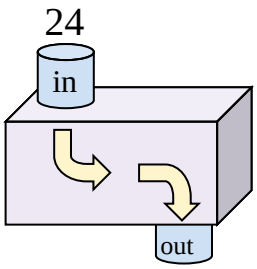

Add 12

10)

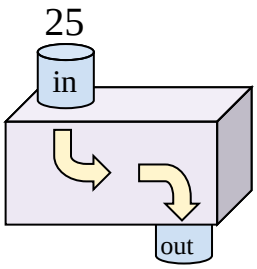

Add 18

11)

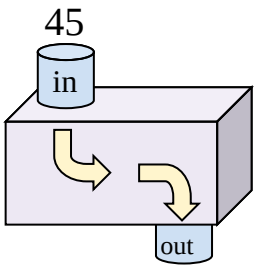

Subtract 35

Answers

Ex.	Add 12
1.	Subtract 30
2.	Add 8
3.	Add 30
4.	Subtract 26
5.	Subtract 22
6.	Subtract 21
7.	Add 18
8.	Subtract 5
9.	Add 12
10.	Add 18
11.	Subtract 35

1-10	91	82	73	64	55	45	36	27	18	9
11	0									

Function Machines (Add & Subtract) Name:

Determine the rule each function machine is using.

Ex)

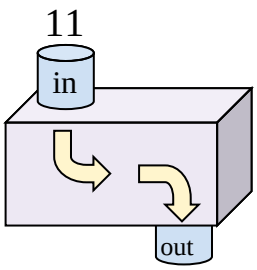

Add 20

1)

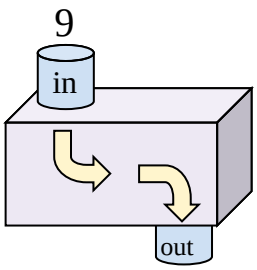

2)

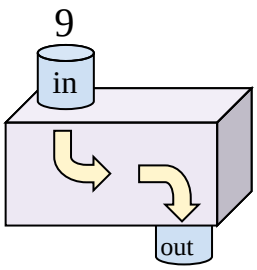

3)

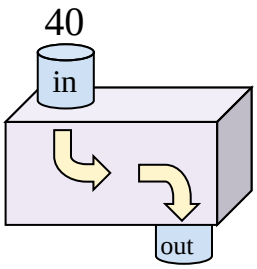

4)

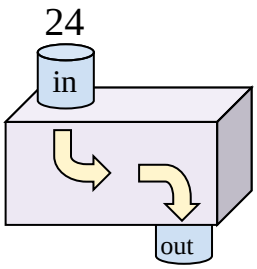

5)

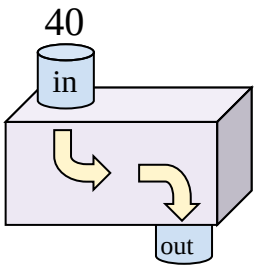

6)

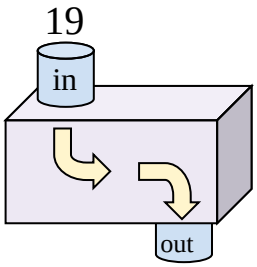

7)

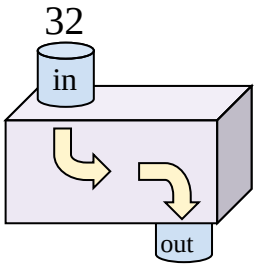

8)

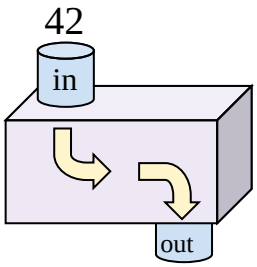

9)

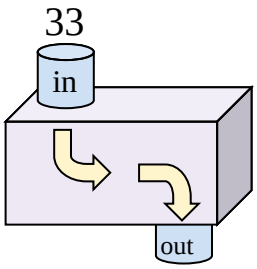

10)

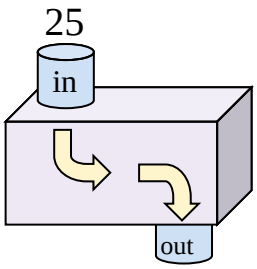

11)

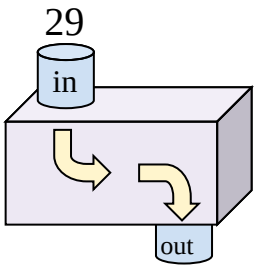

Answers

Ex. Add 20

1. _____
2. _____
3. _____
4. _____
5. _____
6. _____
7. _____
8. _____
9. _____
10. _____
11. _____

1-10	91	82	73	64	55	45	36	27	18	9
11	0									

Function Machines (Add & Subtract) Name: **Answer Key**

Determine the rule each function machine is using.

Ex)

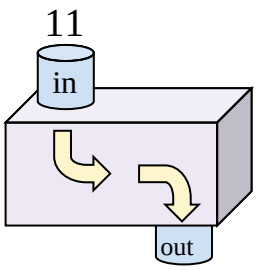

Add 20

1)

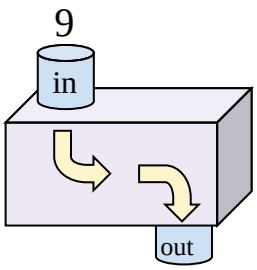

Add 27

2)

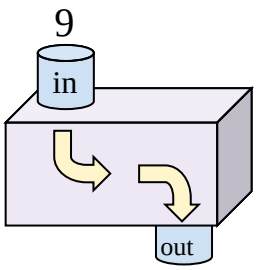

Add 25

3)

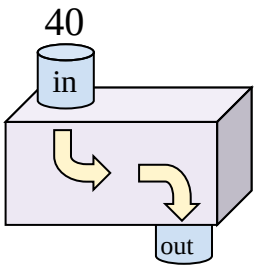

Subtract 28

4)

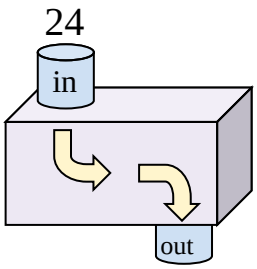

Subtract 6

5)

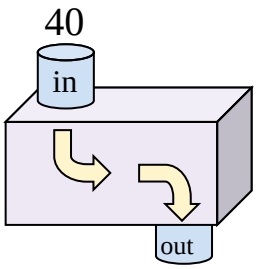

Subtract 34

6)

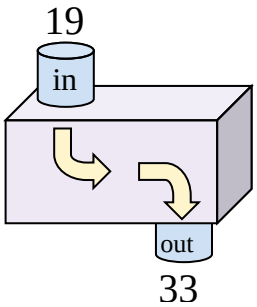

Add 14

7)

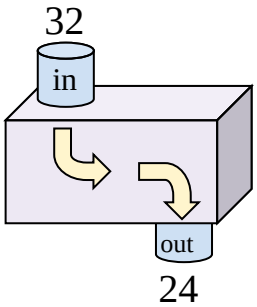

Subtract 8

8)

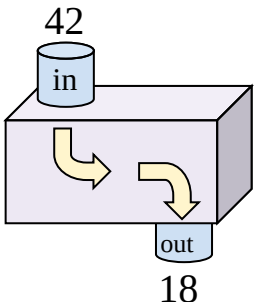

Subtract 24

9)

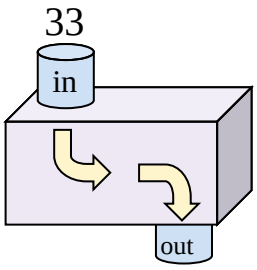

Subtract 25

10)

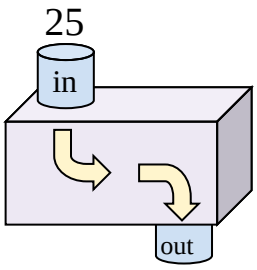

Add 14

11)

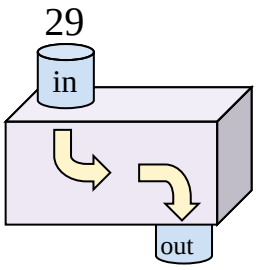

Add 9

Answers

Ex.	Add 20
1.	Add 27
2.	Add 25
3.	Subtract 28
4.	Subtract 6
5.	Subtract 34
6.	Add 14
7.	Subtract 8
8.	Subtract 24
9.	Subtract 25
10.	Add 14
11.	Add 9

1-10	91	82	73	64	55	45	36	27	18	9
11	0									