Function Machines (Add & Subtract) Name:

Determine the rule each function machine is using.

Ex)

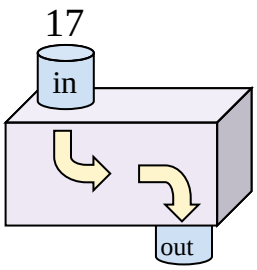

Add 6

1)

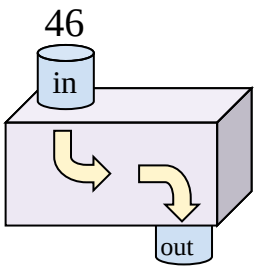

2)

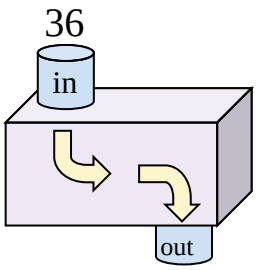

3)

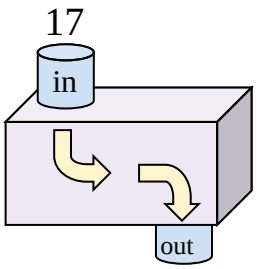

4)

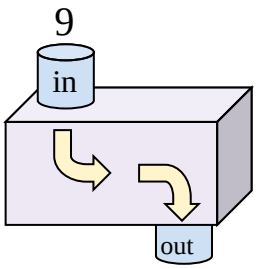

5)

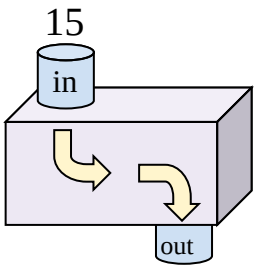

6)

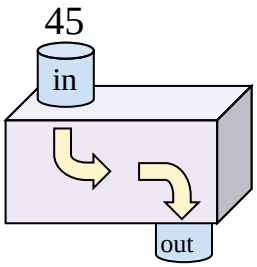

7)

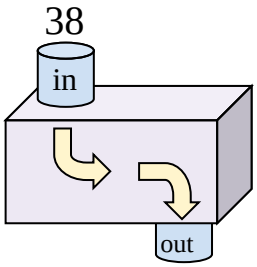

8)

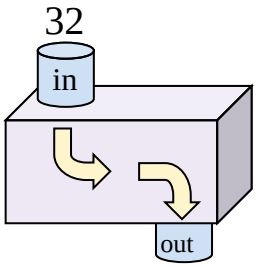

9)

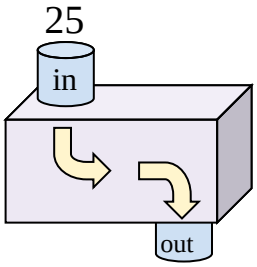

10)

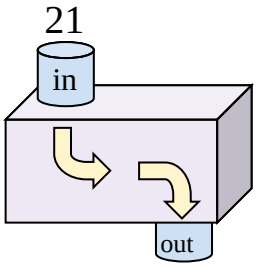

11)

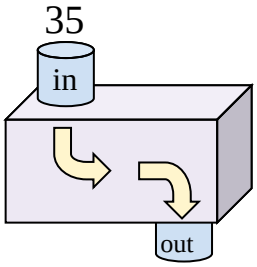

Answers

Ex. Add 6

1. _____
2. _____
3. _____
4. _____
5. _____
6. _____
7. _____
8. _____
9. _____
10. _____
11. _____

Function Machines (Add & Subtract) Name: **Answer Key**

Determine the rule each function machine is using.

Ex)

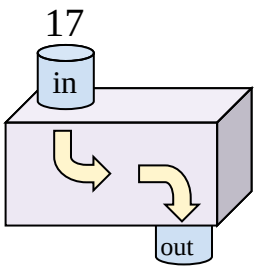

Add 6

1)

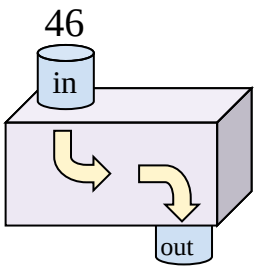

Subtract 31

2)

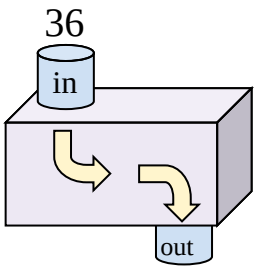

Subtract 6

3)

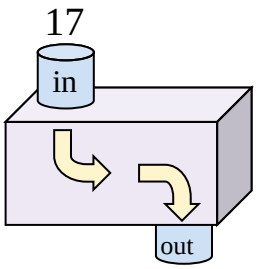

Add 9

4)

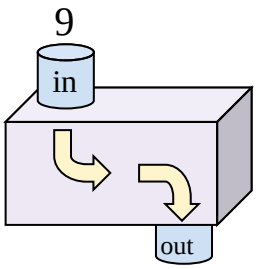

Add 29

5)

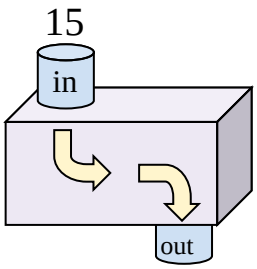

Add 28

6)

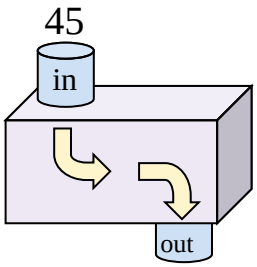

Subtract 15

7)

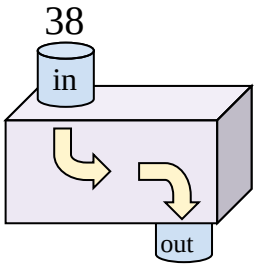

Subtract 28

8)

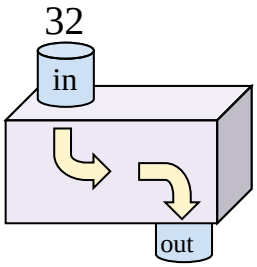

Subtract 26

9)

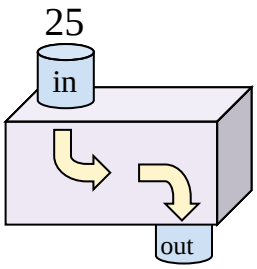

Add 21

10)

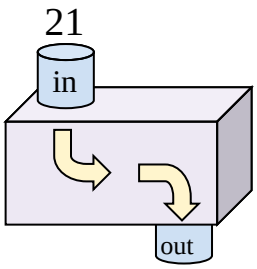

Add 13

11)

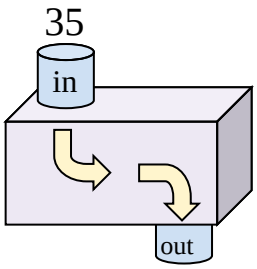

Subtract 14

Answers

Ex.	Add 6
1.	Subtract 31
2.	Subtract 6
3.	Add 9
4.	Add 29
5.	Add 28
6.	Subtract 15
7.	Subtract 28
8.	Subtract 26
9.	Add 21
10.	Add 13
11.	Subtract 14