# Marking Value on a Numberline

Name:

**Mark the location of the number on the numberline.**

**Ex)** 2

0 20

**1)** 11

0 20

**2)** 18

0 20

**3)** 1

0 20

**4)** 8

0 20

**5)** 13

0 20

**6)** 19

0 20

**7)** 10

0 20

**8)** 5

0 20

**9)** 6

0 20

**10)** 7

0 20



| 1-10 | 90 | 80 | 70 | 60 | 50 | 40 | 30 | 20 | 10 | 0 |
|---|---|---|---|---|---|---|---|---|---|---|

Marking Value on a Numberline Name: **Answer Key**

**Mark the location of the number on the numberline.**

**Ex)** 2

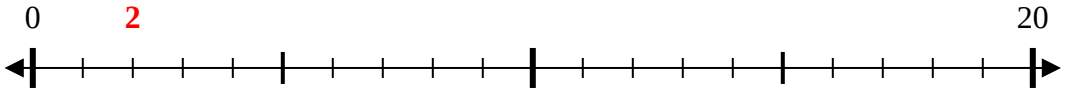


**1)** 11

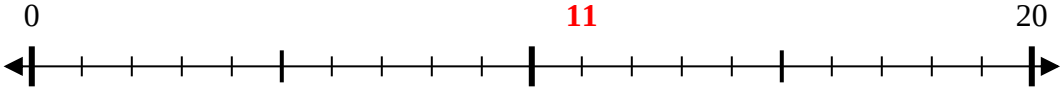


**2)** 18

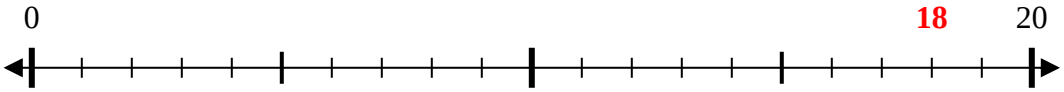


**3)** 1

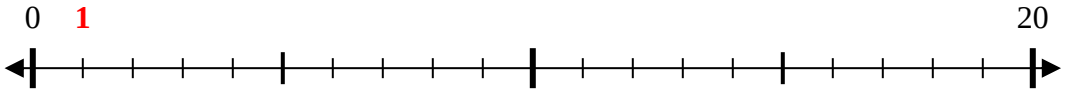


**4)** 8

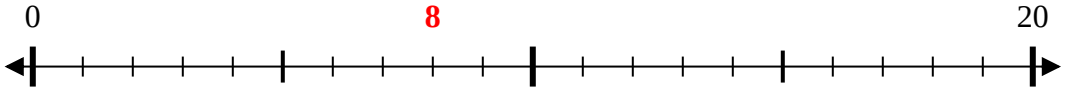


**5)** 13

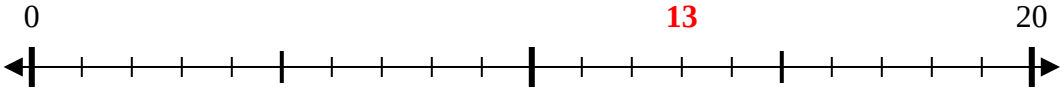


**6)** 19

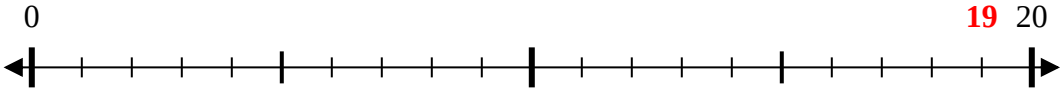


**7)** 10

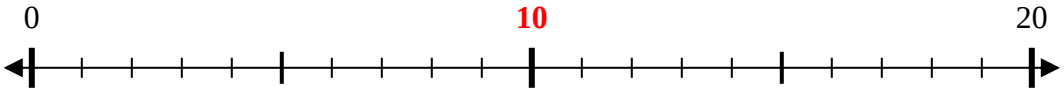


**8)** 5

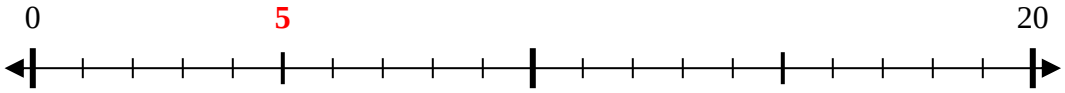


**9)** 6

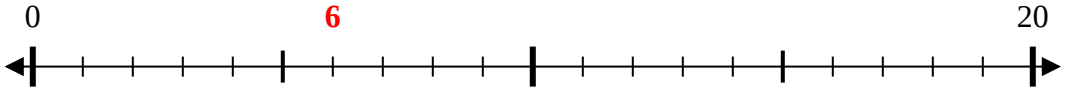


**10)** 7

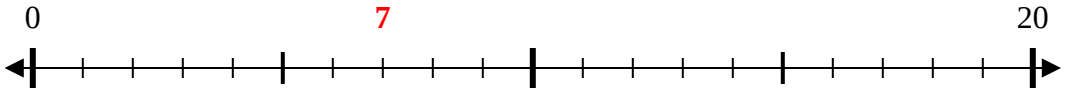




| 1-10 | 90 | 80 | 70 | 60 | 50 | 40 | 30 | 20 | 10 | 0 |
|---|---|---|---|---|---|---|---|---|---|---|